Finding Distance on a Grid

Name:

Find the distance between points.

Ex)

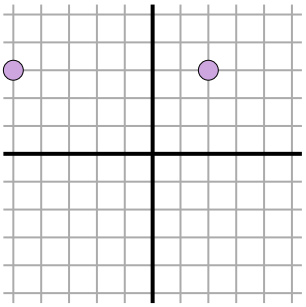

1)

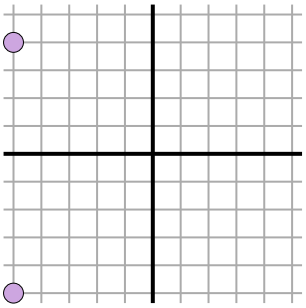

2)

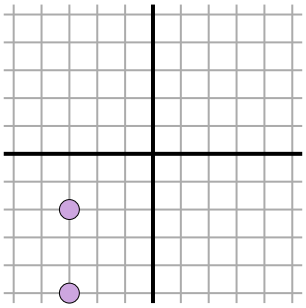

3)

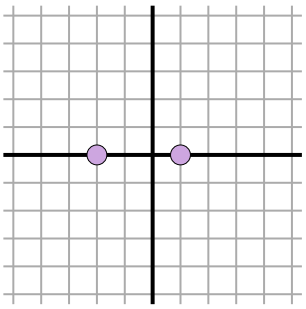

4)

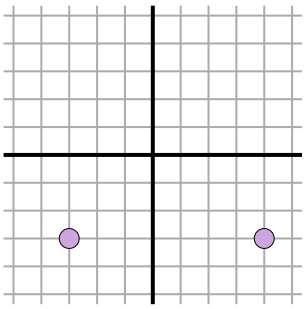

5)

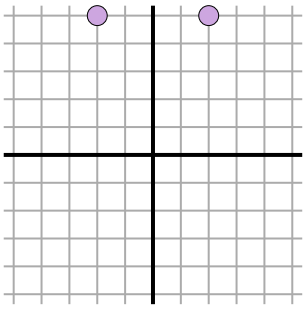

6)

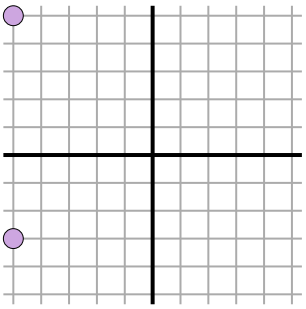

7)

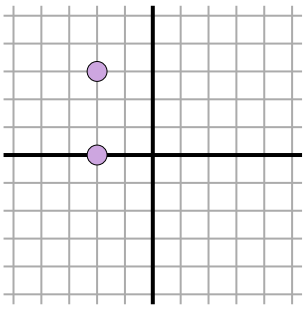

8)

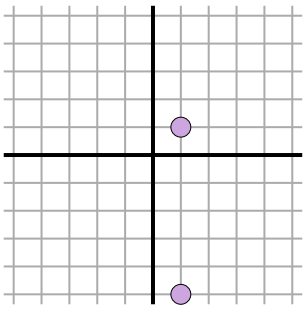

9)

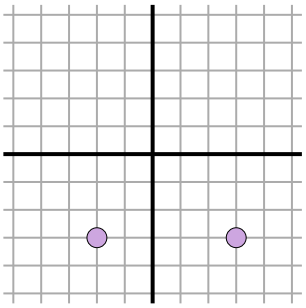

10)

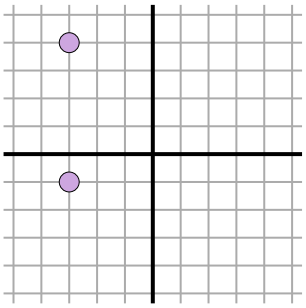

11)

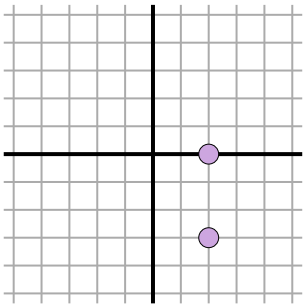

Answers

Ex. 7

1. _____
2. _____
3. _____
4. _____
5. _____
6. _____
7. _____
8. _____
9. _____
10. _____
11. _____

1-10	91	82	73	64	55	45	36	27	18	9
11	0									

Finding Distance on a Grid

Name: **Answer Key**

Find the distance between points.

Ex)

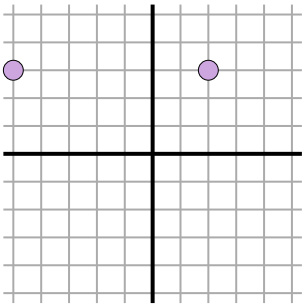

$\sqrt{(2--5)^2 + (3-3)^2}$

$\sqrt{(49) + (0)}$

1)

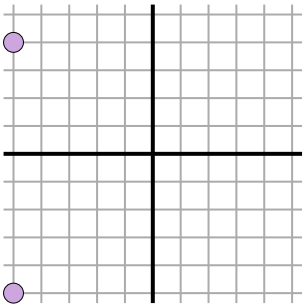

$\sqrt{(-5--5)^2 + (-5-4)^2}$

$\sqrt{(0) + (81)}$

2)

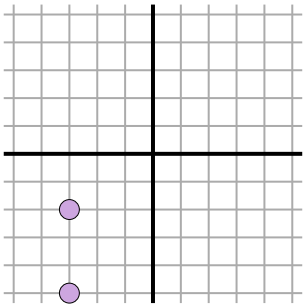

$\sqrt{(-3--3)^2 + (-2--5)^2}$

$\sqrt{(0) + (9)}$

3)

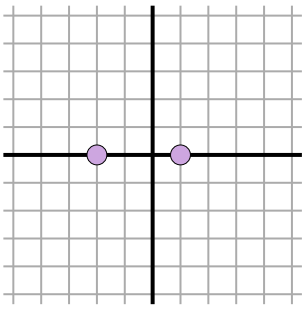

$\sqrt{(1--2)^2 + (0-0)^2}$

$\sqrt{(9) + (0)}$

4)

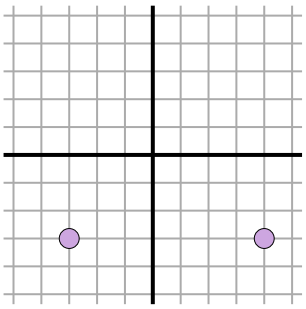

$\sqrt{(-3-4)^2 + (-3--3)^2}$

$\sqrt{(49) + (0)}$

5)

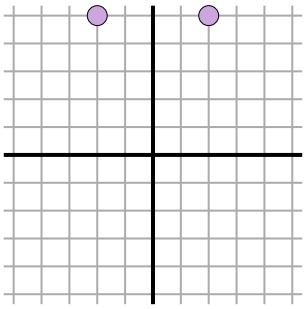

$\sqrt{(-2-2)^2 + (5-5)^2}$

$\sqrt{(16) + (0)}$

6)

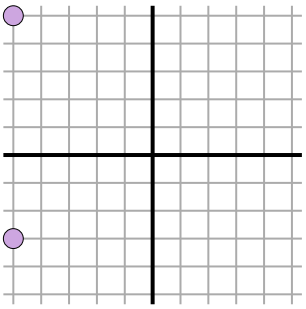

$\sqrt{(-5--5)^2 + (5--3)^2}$

$\sqrt{(0) + (64)}$

7)

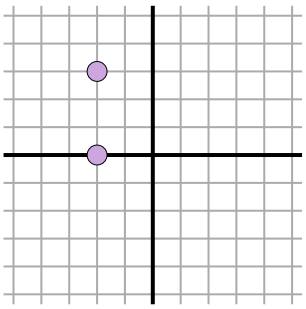

$\sqrt{(-2--2)^2 + (3-0)^2}$

$\sqrt{(0) + (9)}$

8)

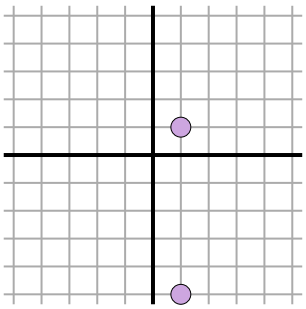

$\sqrt{(1-1)^2 + (1--5)^2}$

$\sqrt{(0) + (36)}$

9)

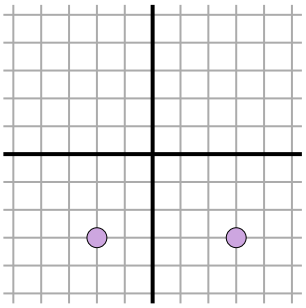

$\sqrt{(-2-3)^2 + (-3--3)^2}$

$\sqrt{(25) + (0)}$

10)

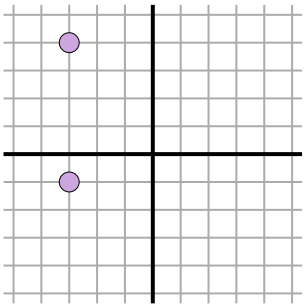

$\sqrt{(-3--3)^2 + (4--1)^2}$

$\sqrt{(0) + (25)}$

11)

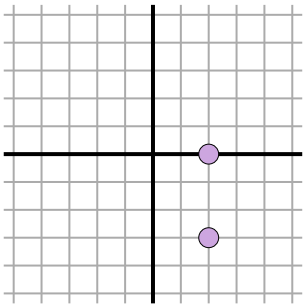

$\sqrt{(2-2)^2 + (0--3)^2}$

$\sqrt{(0) + (9)}$

Answers

Ex.	7
1.	9
2.	3
3.	3
4.	7
5.	4
6.	8
7.	3
8.	6
9.	5
10.	5
11.	3

1-10	91	82	73	64	55	45	36	27	18	9
11	0									